Getallen tot 30

1. In het theater:

Bij sommige entreekaarten ontbreken de nummers. Vul ze in.

1	2	3	4	5
16	17	18	19	20

6	7	8	9	10
21	22	23	24	25

11	12	13	14	15
26	27	28	29	30

2. Met behulp van de symbolen zijn getallen uitgebeeld. Welke zijn het?

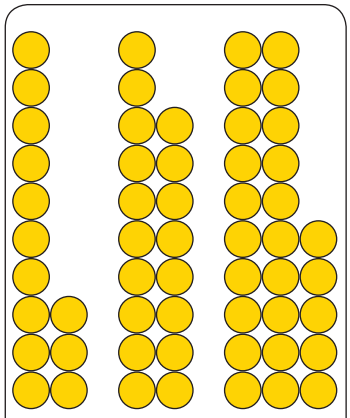

13 18 24



27

30



15 11 29



21

15

18



17

3. Vul de ontbrekende getallen in:

0 1 2 3 4 5 6 7 8 9 10 11 12 13 14 15 16 17 18 19 20 21 22 23 24 25 26 27 28 29 30

JI © Aduis